Biology 452AA
Quiz 1, Summer 2009

1. Key out specimen A using the taxonomic key. Your answer should include ALL of the "steps" you followed to reach your decision (for example: 1A, 2B, 3B, etc, Order _____) (2 pt)

   _____**1B, 5B, 7B, 11A, 12B, Order L**_____**(1B & 5B = ½ pt, all other steps = ¼ pt)**__

2. What term best describes the feet in specimen B? _____**Palmate**_____

3. Circle the primary flight feathers on specimen C.

Specimen A (view 1) (Pel's Fishing Owl)



Specimen A (view 2) (Pel's Fishing Owl)

Specimen B (Brown Noddy)

Specimen C (Frigate Bird wing)



Biology 452AB
Quiz 1, Summer 2009

1. Key out specimen A using the taxonomic key. Your answer should include ALL of the "steps" you followed to reach your decision (for example: 1A, 2B, 3B, etc, Order _____) (2 pt)

   _____**1B, 5B, 7B, 11B, 13A, 14A, Order M**_____**(1B = ½ pt, all other steps = ¼ pt)**__

2. What term best describes the bill in specimen B? _____**Recurved**_____

3. Circle the secondary flight feathers on specimen C.

Specimen A (view 1) (Golden Pheasant)



Specimen A (view 2) (Golden Pheasant)



Specimen B (Eurasian Avocet)

Specimen C (Kestrel wing)