Biology 452AA, Quiz 4 (Mammals)
Summer 2009

1. List the letter of the specimen (A-E) that has the skull shown in X. _____D_____

2. List the letter(s) of the specimen(s) (A-E) that is/are members of the Order Lagomorpha. _____B, E_____

3. What is the complete common name of C? ____Mountain Beaver_____

4. List the letter(s) of the specimen(s) (A-E) that is/are aquatic. _____A, D_____

X	A
B	C 
D	E 

Biology 452AB, Quiz 4 (Mammals)
Summer 2009

1. List the letter of the specimen (A-E) that has the skull shown in X. _____**B**_____

2. List the letter(s) of the specimen(s) (A-E) that is/are members of the Order Rodentia. _____**A, B, C**_____

3. What is the complete common name of C? _____**Douglas Squirrel**_____

4. List the letter(s) of the specimen(s) (A-E) that is/are fossorial. _____**A, D**_____

X	A
B 	C
D	E