Biology 452, Section AA
Quiz 6
Spring 2008

1. List the letter(s) of the skulls with brachyodont (short-crowned) teeth. _____C, D, & F_____

2. List the letter(s) of the skulls that are members of the Order Rodentia. _____A, E_____

3. What is the common name of the skull shown in C? _____Little Brown Bat_____

4. List 1 trait, **visible in this view**, that distinguishes skull D from all placental mammals. jugal contacts mandibular fossa, > 3 incisors, palatal foramina, triangular teeth w sharp cusps

A	B 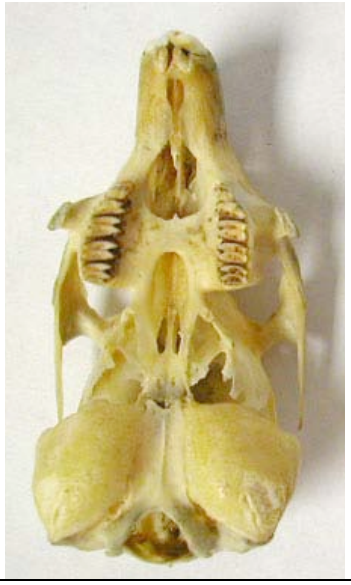	C
D 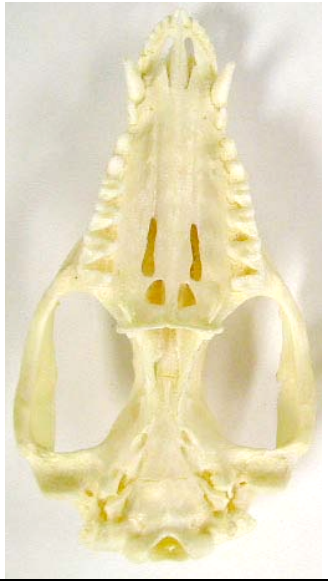	E	F

Biology 452, Section AB
Quiz 6
Spring 2008

1. List the letter of the 1 skull with the most well developed carnassial teeth. _____B_____

2. List the letter(s) of the skulls that are members of the Order Carnivora. _____A, B, C & D_____

3. What is the common name of the skull shown in D? _____Northern Fur Seal_____

4. What is the diet of the mammal with the skull shown in E? _____Insectivore_____

A

B

C

D

E

F

Biology 452, Section AC
Quiz 6
Spring 2008

1. List the letter(s) of the skull(s) with hypsodont (high-crowned) teeth. _____**A, C & E**_____

2. List the letter(s) of the skulls that are members of the Order Artiodactyla. _____**A, D & E**_____

3. What is the common name of the skull shown in C? _____**Horse**_____

4. What is the diet of the mammal with the skull shown in D? _____**Omnivore**_____

A

B

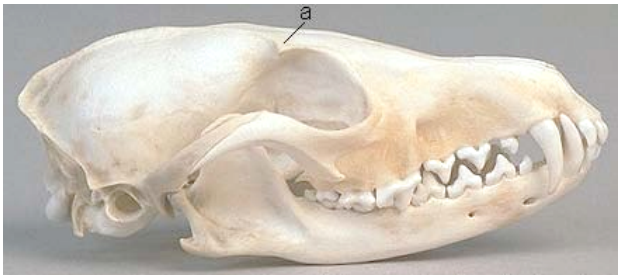

C

D



E

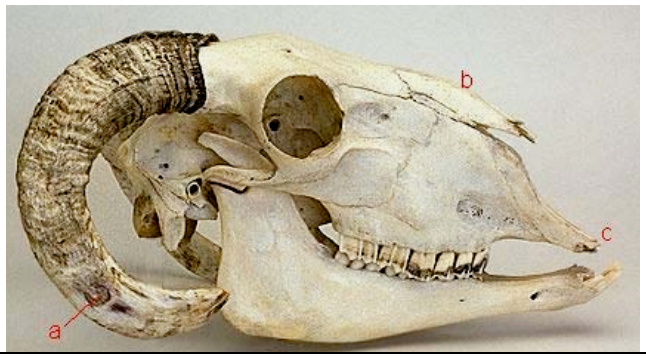

F